Name: _____

Homework 17: Combining filters

On each line, the first two transmission diagrams represent two filters light is passing through in succession. In the third, sketch the approximate shape of the resulting light. Also, color in the rectangle above each with the approximate color it represents.

A)

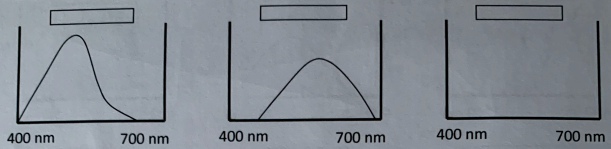

B)

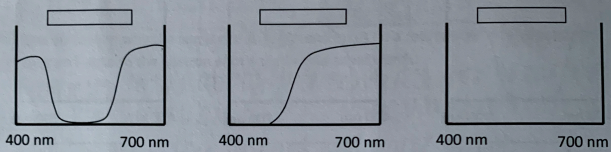

C)

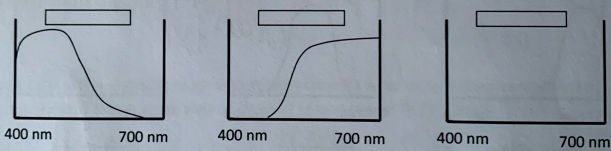

D)

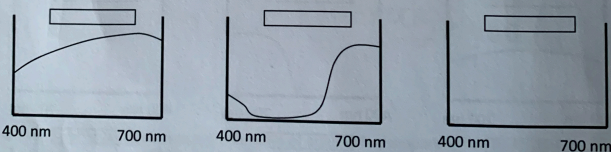
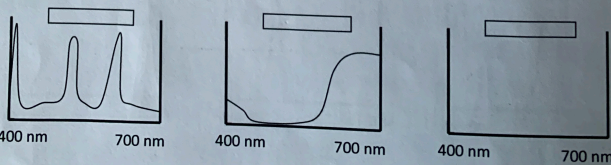
E)